Creating Rectangles with a Coordinate Grid Name:

Find the coordinates of point D to make a rectangle.

Ex)

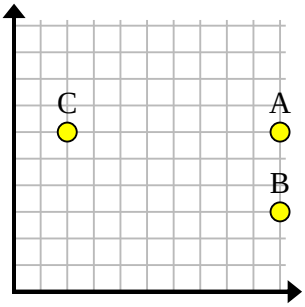

1)

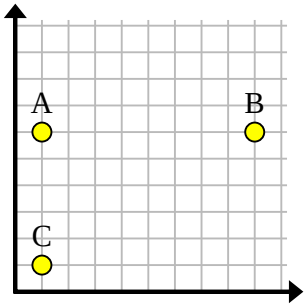

2)

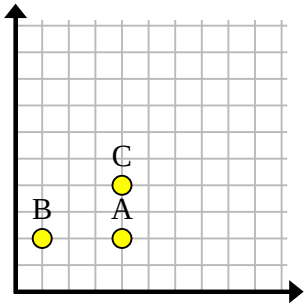

3)

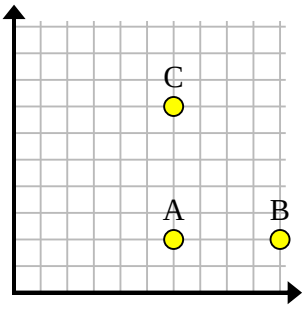

4)

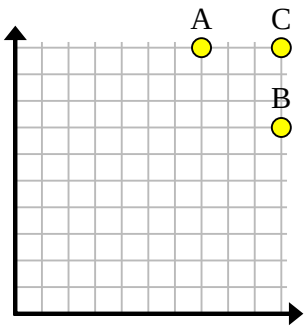

5)

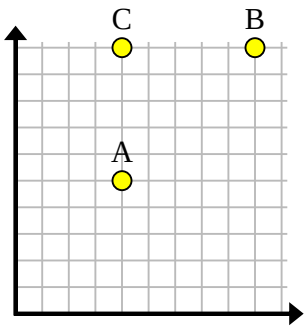

6)

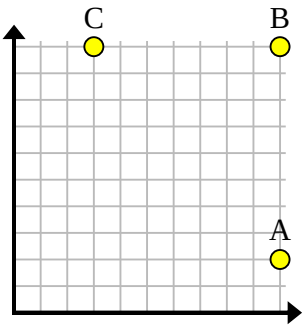

7)

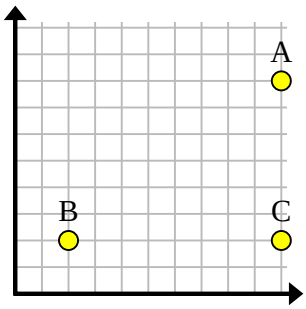

8)

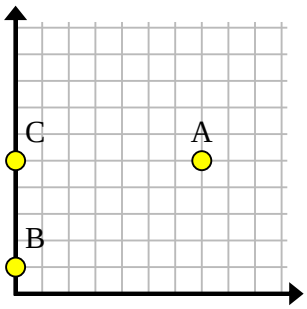

9)

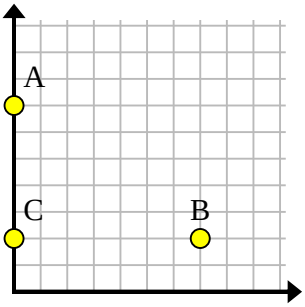

10)

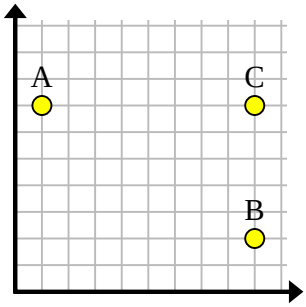

11)

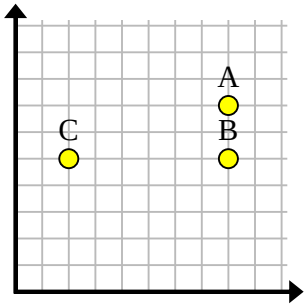

Answers

Ex. (2 , 3)

1. _____
2. _____
3. _____
4. _____
5. _____
6. _____
7. _____
8. _____
9. _____
10. _____
11. _____

1-10	91	82	73	64	55	45	36	27	18	9
11	0									

Creating Rectangles with a Coordinate Grid Name: **Answer Key**

Find the coordinates of point D to make a rectangle.

Ex)

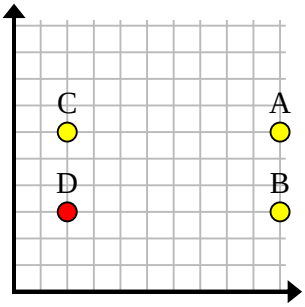

1)

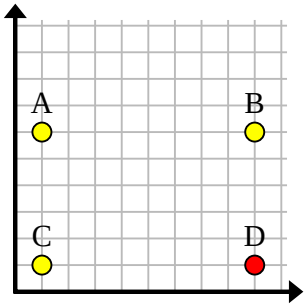

2)

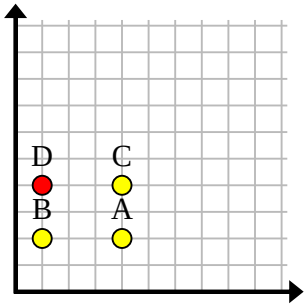

3)

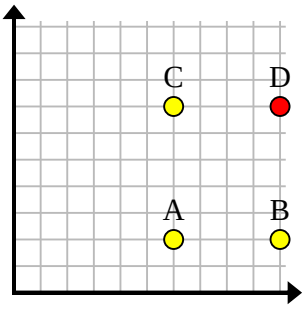

4)

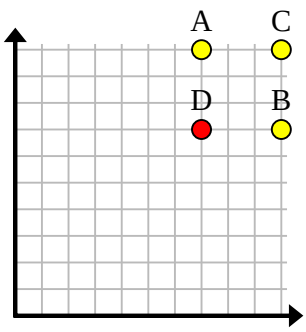

5)

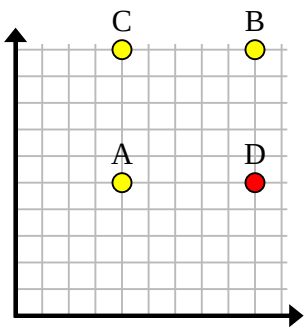

6)

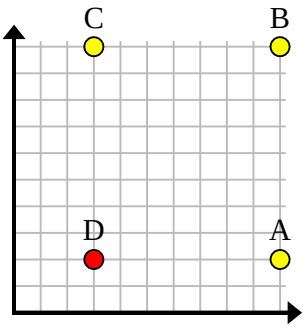

7)

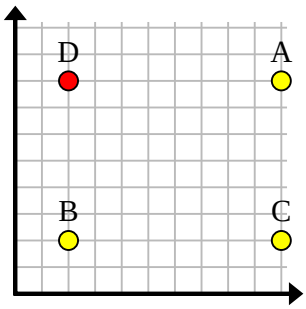

8)

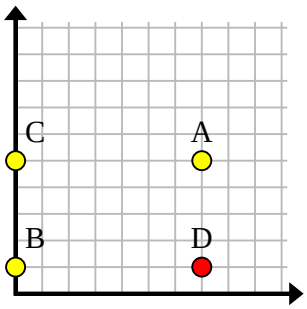

9)

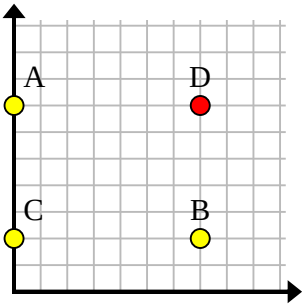

10)

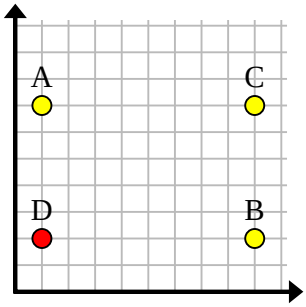

11)

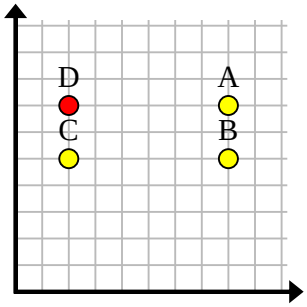

Answers

Ex.	(2, 3)
1.	(9, 1)
2.	(1, 4)
3.	(10, 7)
4.	(7, 7)
5.	(9, 5)
6.	(3, 2)
7.	(2, 8)
8.	(7, 1)
9.	(7, 7)
10.	(1, 2)
11.	(2, 7)

1-10	91	82	73	64	55	45	36	27	18	9
11	0									